Cambridge Assessment International Education

Cambridge O Level

CANDIDATE NAME

CENTRE NUMBER | | | | | |

CANDIDATE NUMBER | | | | |

549176487 7

MATHEMATICS (SYLLABUS D) **4024/11**

Paper 1 Non-calculator **October/November 2025**

2 hours

You must answer on the question paper.

You will need: Geometrical instruments

INSTRUCTIONS

- Answer **all** questions.
- Use a black or dark blue pen. You may use an HB pencil for any diagrams or graphs.
- Write your name, centre number and candidate number in the boxes at the top of the page.
- Write your answer to each question in the space provided.
- Do **not** use an erasable pen or correction fluid.
- Do **not** write on any bar codes.
- Calculators must **not** be used in this paper.
- You may use tracing paper.
- You must show all necessary working clearly.

INFORMATION

- The total mark for this paper is 100.
- The number of marks for each question or part question is shown in brackets [ ].

This document has **20** pages.

© UCLES 2025

[Turn over

https://xtremepape.rs/

List of formulas

Area, A, of triangle, base b, height h.	$A = \frac{1}{2}bh$
Area, A, of circle of radius r.	$A = \pi r^2$
Circumference, C, of circle of radius r.	$C = 2\pi r$
Curved surface area, A, of cylinder of radius r, height h.	$A = 2\pi rh$
Curved surface area, A, of cone of radius r, sloping edge l.	$A = \pi rl$
Surface area, A, of sphere of radius r.	$A = 4\pi r^2$
Volume, V, of prism, cross-sectional area A, length l.	$V = Al$
Volume, V, of pyramid, base area A, height h.	$V = \frac{1}{3}Ah$
Volume, V, of cylinder of radius r, height h.	$V = \pi r^2 h$
Volume, V, of cone of radius r, height h.	$V = \frac{1}{3}\pi r^2 h$
Volume, V, of sphere of radius r.	$V = \frac{4}{3}\pi r^3$
For the equation $ax^2 + bx + c = 0$, where $a \neq 0$,	$x = \frac{-b \pm \sqrt{b^2 - 4ac}}{2a}$

For the triangle shown,

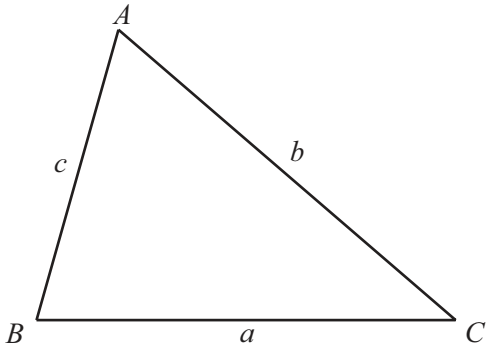

$$\frac{a}{\sin A} = \frac{b}{\sin B} = \frac{c}{\sin C}$$

$$a^2 = b^2 + c^2 - 2bc\cos A$$

$$\text{Area} = \frac{1}{2}ab\sin C$$

DO NOT WRITE IN THIS MARGIN
DO NOT WRITE IN THIS MARGIN
DO NOT WRITE IN THIS MARGIN
DO NOT WRITE IN THIS MARGIN
DO NOT WRITE IN THIS MARGIN

https://xtremepape.rs/

Calculators must **not** be used in this paper.

1 Write down the reciprocal of $\frac{7}{2}$.

..... [1]

2 Some children record the number of hours they each spend watching television one day.
These are the results.

1 2 2 2 6 7 7 8 10

(a) Write down the mode.

..... [1]

(b) One of the 9 children is chosen at random.

Find the probability that this child spends more than 6 hours watching television on this day.

..... [1]

3 A shirt costs $24.
In a sale the cost is reduced by 15%.

Work out the cost of the shirt in the sale.

$ ..... [2]

DO NOT WRITE IN THIS MARGIN
DO NOT WRITE IN THIS MARGIN
DO NOT WRITE IN THIS MARGIN
DO NOT WRITE IN THIS MARGIN
DO NOT WRITE IN THIS MARGIN

https://xtremepape.rs/

4 The diagram shows five straight lines.

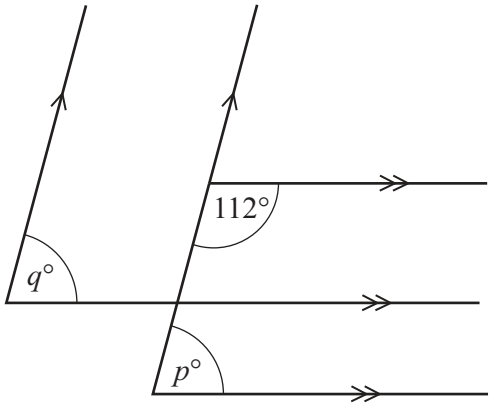

NOT TO SCALE

The diagram shows three horizontal parallel lines and two sloping parallel lines.

(a) Find the value of p.
Give a geometrical reason to explain your answer.

p = ... because .....

..... [2]

(b) Find the value of q.
Give a geometrical reason to explain your answer.

q = ... because .....

..... [2]

DO NOT WRITE IN THIS MARGIN

https://xtremepape.rs/

5 The table shows how some people travel to work.

Type of travel	Number of people	Pie chart angle
Cycle	20	120°
Walk	12	72°
Car		
Bus	5	

(a) Complete the table. [2]

(b) Complete the pie chart to show the information in the table.

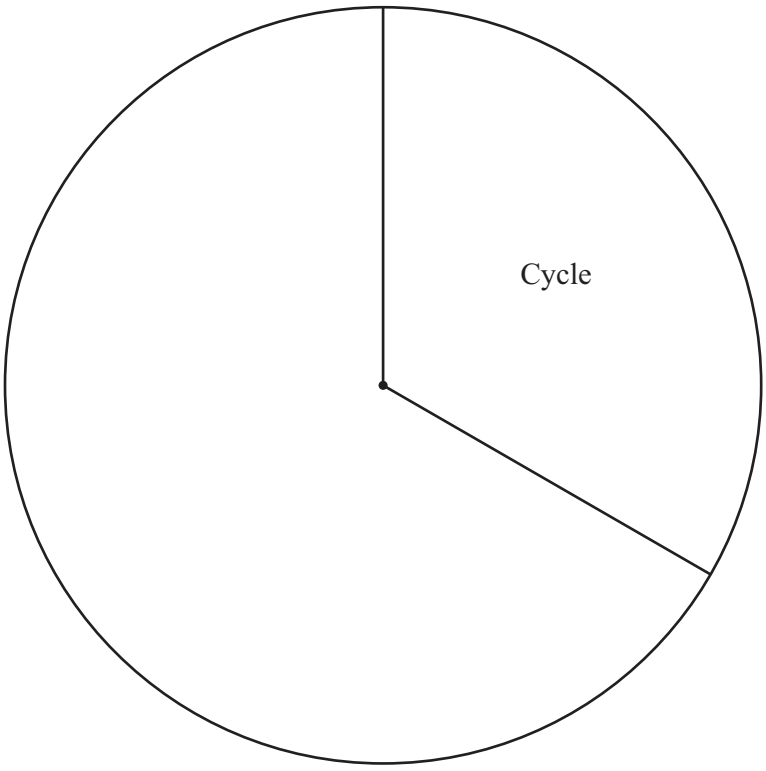

[2]

DO NOT WRITE IN THIS MARGIN
DO NOT WRITE IN THIS MARGIN
DO NOT WRITE IN THIS MARGIN
DO NOT WRITE IN THIS MARGIN
DO NOT WRITE IN THIS MARGIN

https://xtremepape.rs/

6 Sam buys some chocolate.

He eats $\frac{2}{7}$ of the chocolate.

The mass of the **remaining** chocolate is 350 g.

Work out the mass of the chocolate Sam buys.

..... g [2]

7

Car hire
\$40 per day **plus** \$0.30 per kilometre

Amy hires a car for 10 days.
She pays a total of \$670.

Work out the number of kilometres Amy travels in the car.

..... km [3]

DO NOT WRITE IN THIS MARGIN

https://xtremepape.rs/

8 The diagram shows triangle A and triangle B.

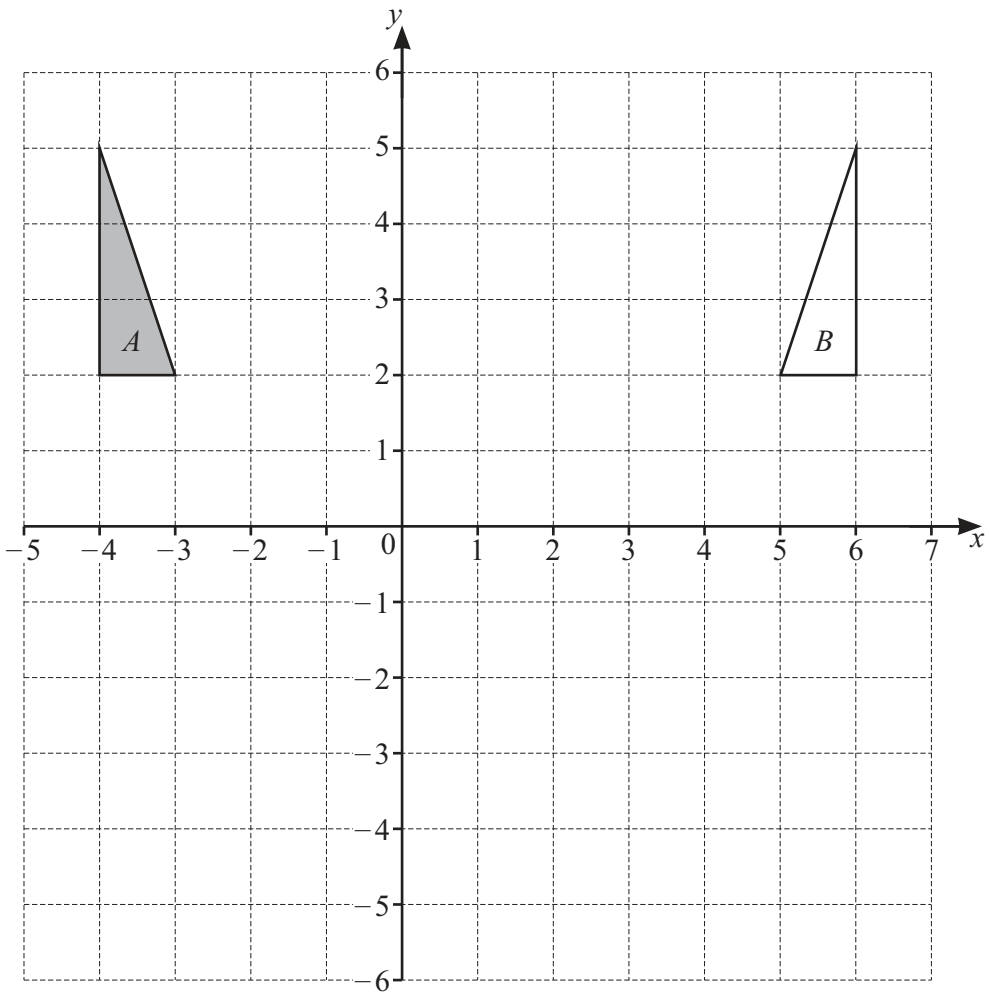

(a) Describe fully the **single** transformation that maps triangle A onto triangle B.

.....

..... [2]

(b) Draw the image of triangle A after a rotation of 180° about centre (0, 0). [2]

DO NOT WRITE IN THIS MARGIN
DO NOT WRITE IN THIS MARGIN
DO NOT WRITE IN THIS MARGIN
DO NOT WRITE IN THIS MARGIN
DO NOT WRITE IN THIS MARGIN

https://xtremepape.rs/

9 By writing each number correct to 1 significant figure, work out an estimate for the value of

$$\frac{\sqrt{102.5} \times 8.7}{27}.$$

..... [2]

10 A circle has diameter 12 cm.

Find the area of the circle.
Give your answer in terms of π.

..... cm^2 [2]

11 A bag contains 10 plums.
The mean mass of 6 of the plums is 50 g.
The mean mass of the remaining 4 plums is 40 g.

Calculate the mean mass of all 10 plums in the bag.

..... g [3]

DO NOT WRITE IN THIS MARGIN

https://xtremepape.rs/

12

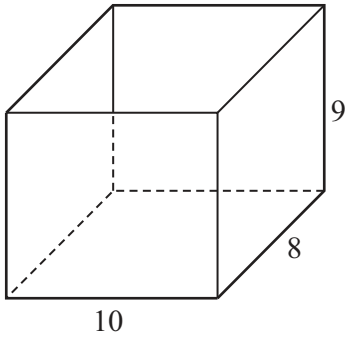

NOT TO SCALE

The diagram shows an empty container.
The container is a cuboid of width 10 cm, length 8 cm and height 9 cm.
Water drips into the container at a rate of 6 millilitres per second.

Find the time, in seconds, it takes to fill the container.

..... seconds [3]

13 Work out $2\frac{2}{3}+3\frac{3}{4}$.

Give your answer as a mixed number in its simplest form.

..... [3]

DO NOT WRITE IN THIS MARGIN
DO NOT WRITE IN THIS MARGIN
DO NOT WRITE IN THIS MARGIN
DO NOT WRITE IN THIS MARGIN
DO NOT WRITE IN THIS MARGIN

https://xtremepape.rs/

14

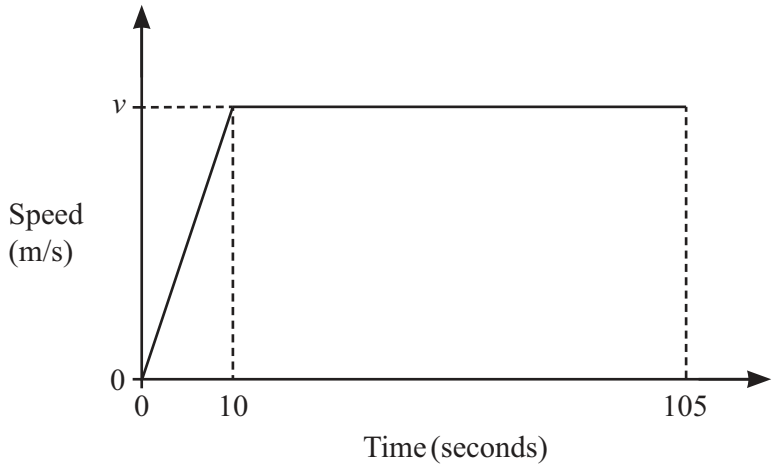

NOT TO SCALE

Lia cycles 800 m in 105 seconds.
The diagram shows the speed–time graph for this journey.

(a) Work out the value of v.

$v =$ ..... [2]

(b) Work out Lia's acceleration during the first 10 seconds.

..... m/s^2 [1]

DO NOT WRITE IN THIS MARGIN
DO NOT WRITE IN THIS MARGIN
DO NOT WRITE IN THIS MARGIN
DO NOT WRITE IN THIS MARGIN
DO NOT WRITE IN THIS MARGIN

https://xtremepape.rs/

15 The cumulative frequency diagram shows information about journey times.

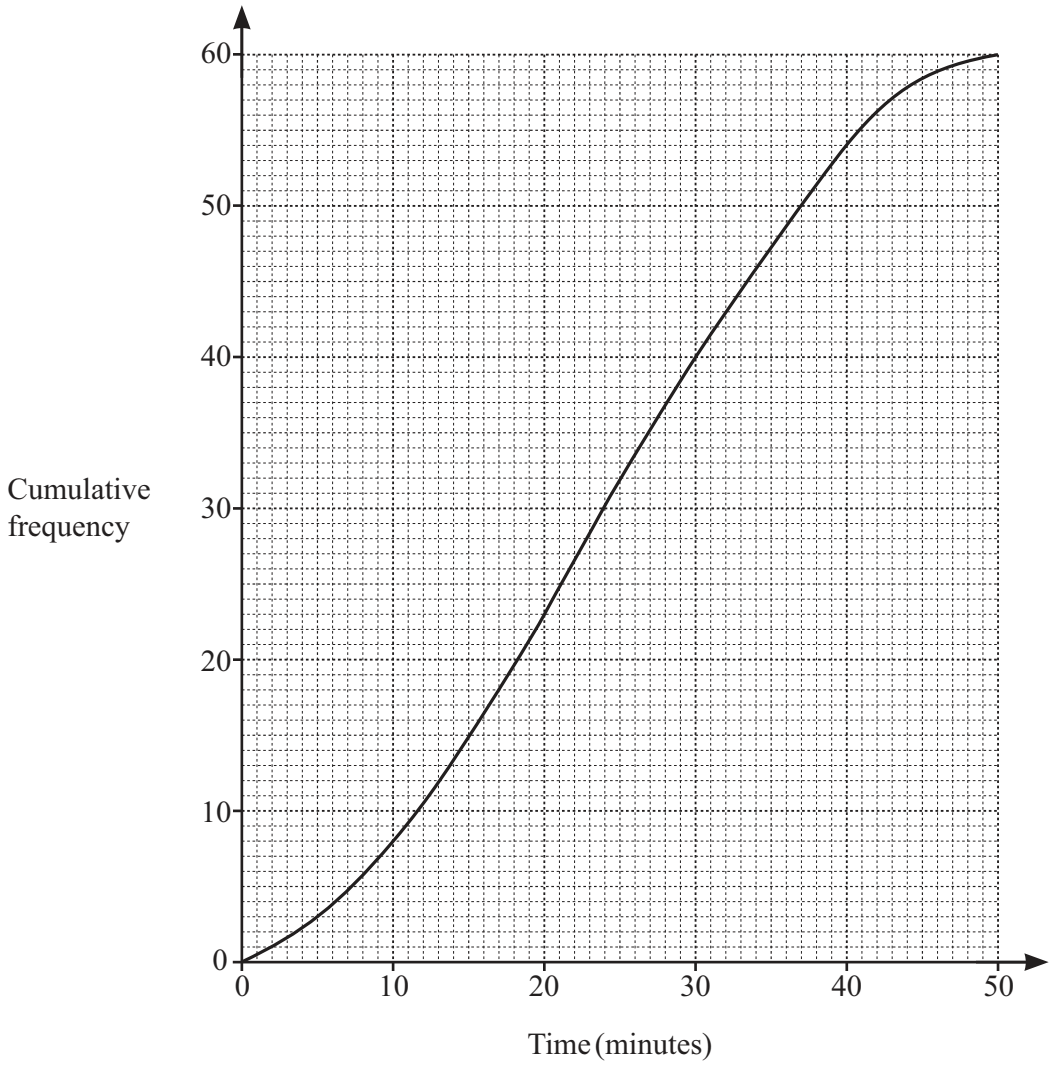

Use the cumulative frequency diagram to find an estimate for

(a) the median

..... minutes [1]

(b) the number of journeys that took 20 minutes or more.

..... [2]

DO NOT WRITE IN THIS MARGIN
DO NOT WRITE IN THIS MARGIN
DO NOT WRITE IN THIS MARGIN
DO NOT WRITE IN THIS MARGIN
DO NOT WRITE IN THIS MARGIN

https://xtremepape.rs/

16

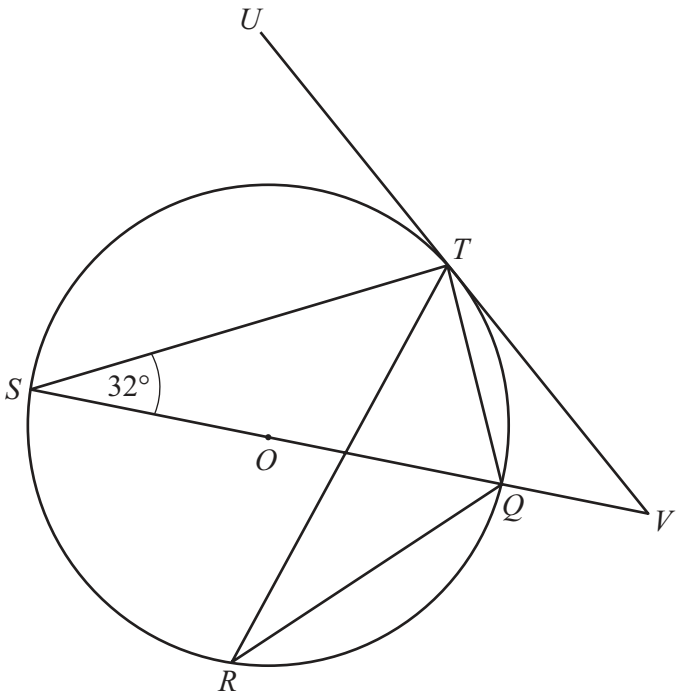

NOT TO SCALE

Points Q, R, S and T lie on a circle, centre O.
UV is a tangent to the circle at T.
$SOQV$ is a straight line.
Angle $QST = 32°$.

(a) Find angle QRT.
Give a geometrical reason to explain your answer.

Angle QRT = ... because .....

..... [2]

(b) Find angle TQS.

Angle TQS = ... [2]

(c) Find angle TVQ.

Angle TVQ = ... [2]

DO NOT WRITE IN THIS MARGIN

https://xtremepape.rs/

17

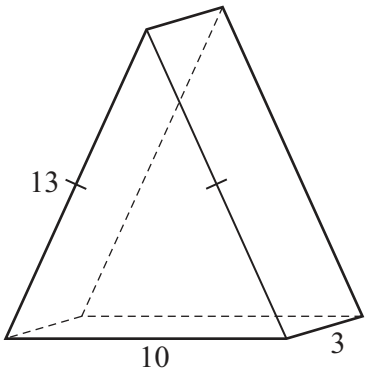

NOT TO SCALE

The diagram shows a prism.
The cross-section of the prism is an isosceles triangle with sides 13 cm, 13 cm and base 10 cm.
The length of the prism is 3 cm.

(a) Show that the volume of the prism is 180 cm^3.

[4]

(b) A mathematically similar prism has a volume of 1440 cm^3.
The cross-section of this prism is an isosceles triangle with base x cm.

Calculate the value of x.

$x =$ ..... [3]

DO NOT WRITE IN THIS MARGIN
DO NOT WRITE IN THIS MARGIN
DO NOT WRITE IN THIS MARGIN
DO NOT WRITE IN THIS MARGIN
DO NOT WRITE IN THIS MARGIN

https://xtremepape.rs/

18 Write $0.1\dot{4}$ as a fraction.

..... [2]

19 $g(x) = \frac{x}{2} + 4$ $h(x) = 3x - 1$

Solve $hg(x) = 5$.

$x =$ ..... [3]

DO NOT WRITE IN THIS MARGIN
DO NOT WRITE IN THIS MARGIN
DO NOT WRITE IN THIS MARGIN
DO NOT WRITE IN THIS MARGIN
DO NOT WRITE IN THIS MARGIN

https://xtremepape.rs/

20 Write as a single fraction in its simplest form.

$$\frac{5}{2x} - \frac{4}{7x}$$

..... [2]

21 **(a)** Evaluate.

$$27^{-\frac{2}{3}}$$

..... [2]

(b) Simplify.

$$\left(\frac{1}{100}x^{100}\right)^{\frac{1}{2}}$$

..... [2]

DO NOT WRITE IN THIS MARGIN

https://xtremepape.rs/

22 The table shows some values for $y = x^3 - 3x + 2$.

x	-3	-2	-1	0	1	2	3
y	-16		4	2	0		20

(a) Complete the table. [2]

(b) Draw the graph of $y = x^3 - 3x + 2$ for $-3 \leqslant x \leqslant 3$.

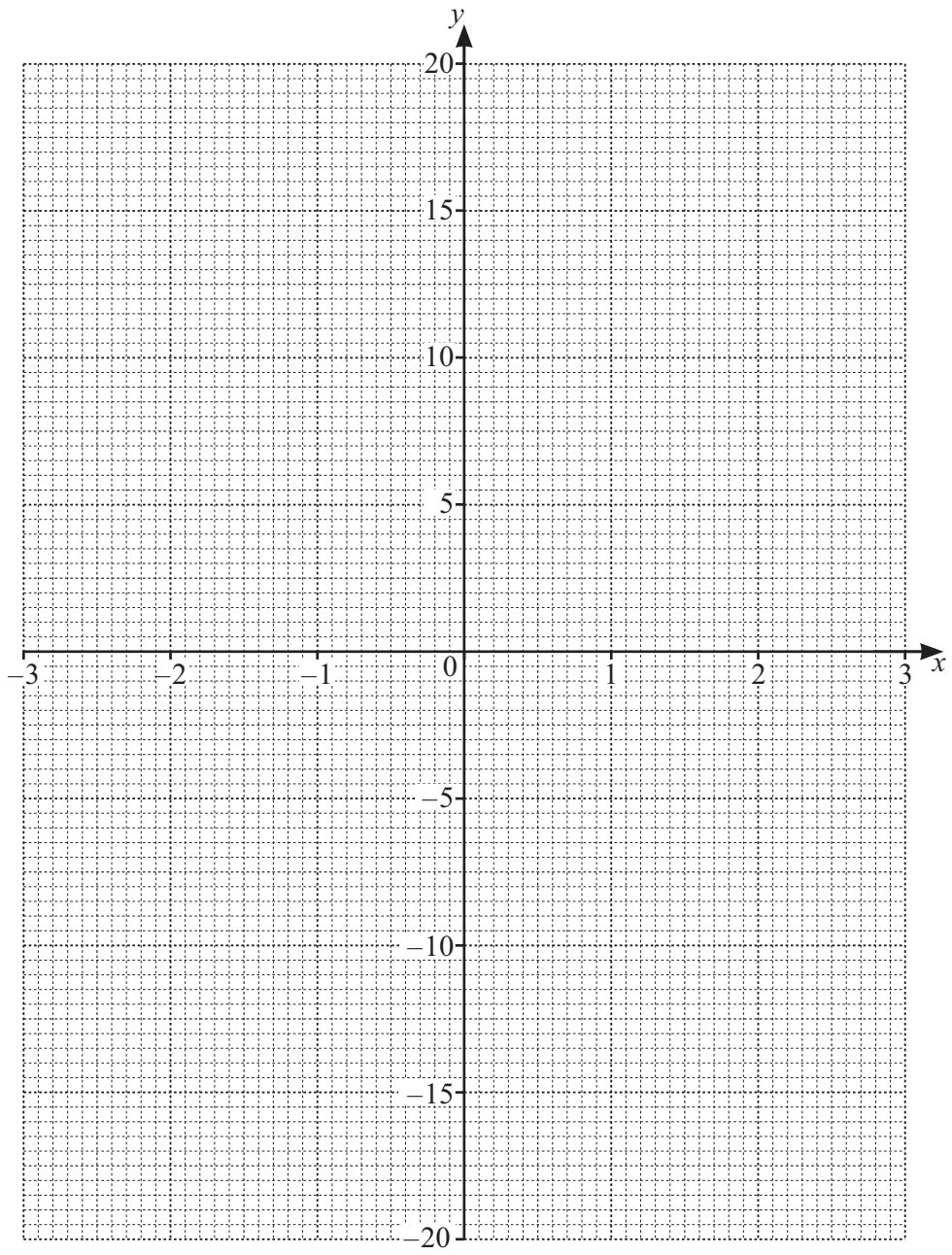

[4]

DO NOT WRITE IN THIS MARGIN
DO NOT WRITE IN THIS MARGIN
DO NOT WRITE IN THIS MARGIN
DO NOT WRITE IN THIS MARGIN
DO NOT WRITE IN THIS MARGIN
https://xtremepape.rs/

(c) By drawing a suitable line on the grid, find the solutions of the equation $x^3 - 7x + 1 = 0$.

$x =$ ..... or $x =$ ..... or $x =$ ..... [4]

23 **(a)** Simplify.

$\sqrt{8} \times \sqrt{6} + \sqrt{3}$

..... [2]

(b) Rationalise the denominator and simplify.

$\dfrac{3}{2 - \sqrt{5}}$

..... [3]

DO NOT WRITE IN THIS MARGIN

https://xtremepape.rs/

24 The diagram shows a rectangle and a triangle.

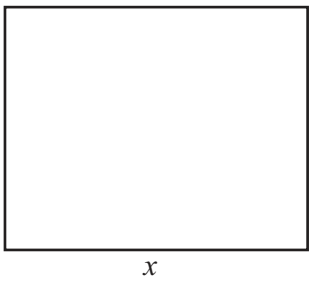

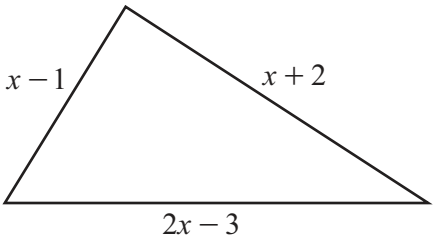

NOT TO SCALE

The length of the rectangle is x cm and the area of the rectangle is $30\,\text{cm}^2$.
The triangle has sides of length $(x-1)$ cm, $(x+2)$ cm and $(2x-3)$ cm.

(a) Write down an expression, in terms of x, for the width of the rectangle.

..... cm [1]

(b) The perimeter of the rectangle is equal to the perimeter of the triangle.

Form an equation in x and show that it simplifies to $x^2 - x - 30 = 0$.

[4]

DO NOT WRITE IN THIS MARGIN

https://xtremepape.rs/

(c) Solve the equation $x^2 - x - 30 = 0$.

$x =$ ..... or $x =$ ..... [3]

(d) Work out the perimeter of the rectangle.

..... cm [2]

25 Factorise.

$6x^3 + 5x^2 - 4x$

..... [3]

DO NOT WRITE IN THIS MARGIN
DO NOT WRITE IN THIS MARGIN
DO NOT WRITE IN THIS MARGIN
DO NOT WRITE IN THIS MARGIN
DO NOT WRITE IN THIS MARGIN

https://xtremepape.rs/

26

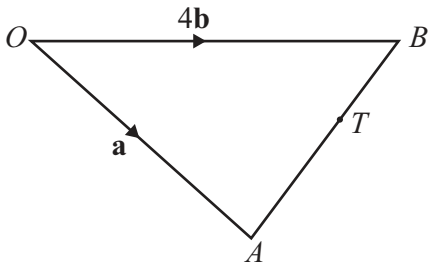

NOT TO SCALE

The diagram shows triangle OAB.
$\overrightarrow{OA} = \mathbf{a}$ and $\overrightarrow{OB} = 4\mathbf{b}$.
T is a point on AB such that $AT : TB = 3 : 2$.

(a) Find $\overrightarrow{AB}$ in terms of $\mathbf{a}$ and $\mathbf{b}$.

$\overrightarrow{AB} =$ ..... [1]

(b) Show that the position vector of T is $\frac{2}{5}(\mathbf{a}+6\mathbf{b})$.

[3]

(c) Q is a point on OB and $\overrightarrow{QT} = \frac{1}{5}(2\mathbf{a}-3\mathbf{b})$.

Find $OQ : QB$.

..... : ..... [3]

Permission to reproduce items where third-party owned material protected by copyright is included has been sought and cleared where possible. Every reasonable effort has been made by the publisher (UCLES) to trace copyright holders, but if any items requiring clearance have unwittingly been included, the publisher will be pleased to make amends at the earliest possible opportunity.

To avoid the issue of disclosure of answer-related information to candidates, all copyright acknowledgements are reproduced online in the Cambridge Assessment International Education Copyright Acknowledgements Booklet. This is produced for each series of examinations and is freely available to download at www.cambridgeinternational.org after the live examination series.

Cambridge Assessment International Education is part of Cambridge Assessment. Cambridge Assessment is the brand name of the University of Cambridge Local Examinations Syndicate (UCLES), which is a department of the University of Cambridge.

DO NOT WRITE IN THIS MARGIN
DO NOT WRITE IN THIS MARGIN
DO NOT WRITE IN THIS MARGIN
DO NOT WRITE IN THIS MARGIN
DO NOT WRITE IN THIS MARGIN

https://xtremepape.rs/